Year 1 - Division — Lesson Guide

Step 1

10 shared into 2 equal groups is ☐



10 shared into 2 equal groups means we give each group the same number of counters. How many are in each group?

Step 2

10 shared into 2 equal groups is ☐

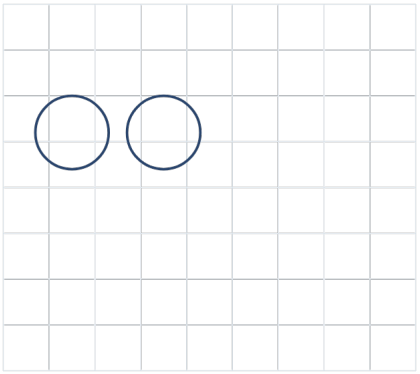

Remember: The number 2 tells us how many circles to draw. The answer tells us how many counters are in one circle.

We draw 2 circles the same size, one for each group. We share the 10 counters one round at a time. Put one in the first circle and one in the second circle, then start again.

Step 3

10 shared into 2 equal groups is ☐

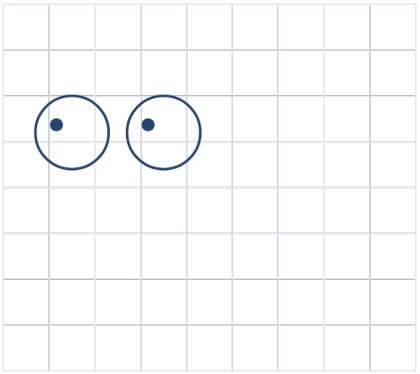

Put one counter in the first circle. Put one counter in the second circle. We have shared 2 counters. Each circle has 1 counter.

Step 4

10 shared into 2 equal groups is ☐

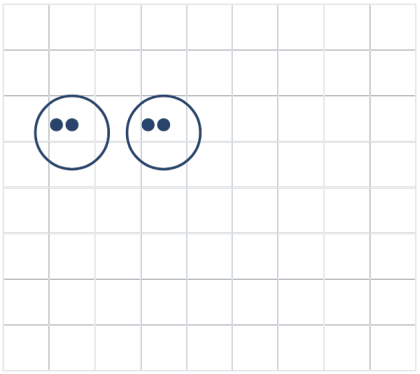

Give each group one more counter. Now each group has 2.

Step 5

10 shared into 2 equal groups is ☐

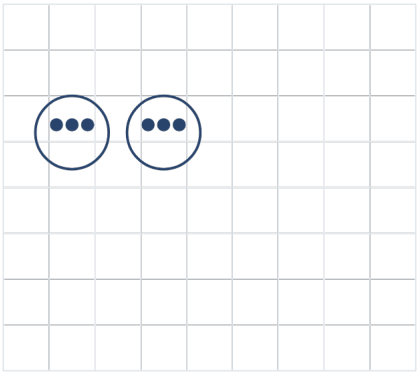

Give each group one more counter. Now each group has 3.

Step 6

10 shared into 2 equal groups is ☐

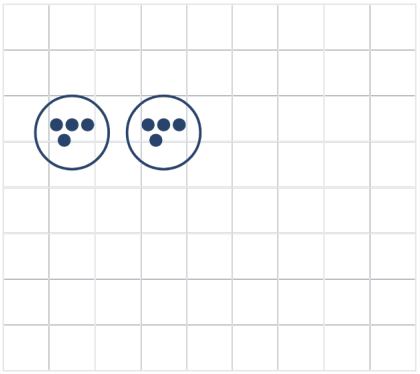

Give each group one more counter. Now each group has 4.

Step 7

10 shared into 2 equal groups is ☐

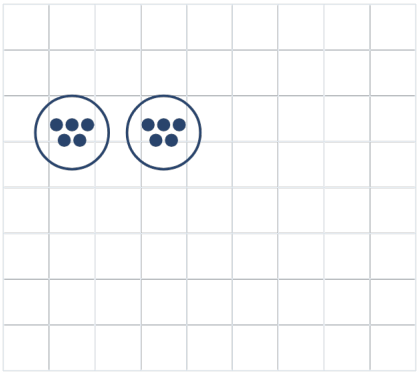

Give each group one more counter. Now each group has 5.

Step 8

10 shared into 2 equal groups is ☐

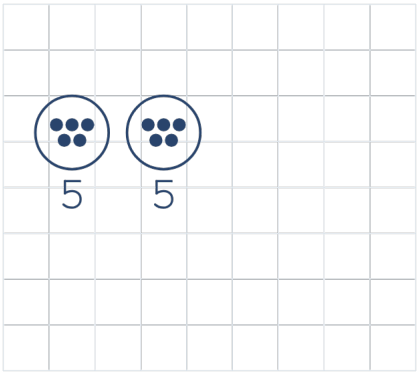

All 10 counters have been shared. The counters are in matching rows, so each circle has the same number. Count the counters in one circle. There are 5 counters in each circle. Write 5 under each circle.

Step 9

10 shared into 2 equal groups is **5**

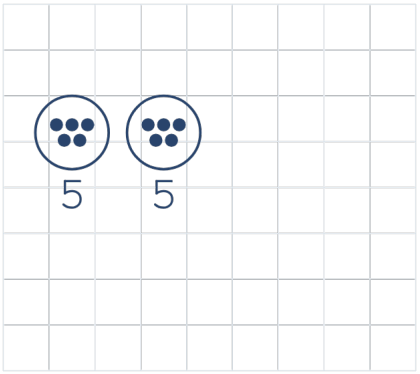

10 shared equally into 2 groups gives 5 in each group. Write 5 in the answer box.